GRADE 2 – LESSON 3

A. Look, read and circle the correct picture

E.g. eleven

11 13 12

1. thirteen

14 3 13

2. fourteen

4 12 14

3. twelve

13 12 15

4. fifteen

15 11 5

B. Choose the correct answer

E.g. How many ..... are there? - Four.

a. pencils
b. apples
c. alligators

1. How many robots are there?

a. Thirteen.
b. Twelve.
c. Nine.



2. How many ..... are there? Thirteen.

a. letters
b. pencils
c. crayons

abcdefghiklmn

3. How many chairs are there?

a. Eleven.
b. Twelve.
c. Fourteen.



4. How many horses are there?

a. Eleven.
b. Eight.
c. Fifteen.



C. Write

N
n
eleven
fifteen

GRADE 2 – LESSON 3

A. Look, read and circle the correct picture

E.g. eleven

11 13 12

1. thirteen

14 3 13

2. fourteen

4 12 14

3. twelve

13 12 15

4. fifteen

15 11 5

B. Choose the correct answer

E.g. How many ..... are there? - Four.

a. pencils
b. apples
c. alligators

1. How many robots are there?

a. Thirteen.
b. Twelve.
c. Nine.



2. How many ..... are there? Thirteen.

a. letters
b. pencils
c. crayons

abcdefghiklmn

3. How many chairs are there?

a. Eleven.
b. Twelve.
c. Fourteen.



4. How many horses are there?

a. Eleven.
b. Eight.
c. Fifteen.



C. Write

N
n
eleven
fifteen